Math 8th Name_____ ID: 1

© 2016 Kuta Software LLC. All rights reserved.

QUIZ - VOLUME

Date_____ Period____

Find the volume of each figure. Round your answers to the nearest whole, if necessary.

1)

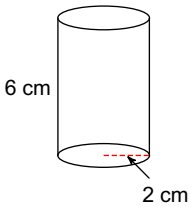

A) 68 cm^3 B) 75 cm^3
C) 83 cm^3 D) 106 cm^3

2)

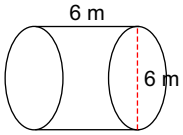

A) 170 m^3 B) 216 m^3
C) 679 m^3 D) 244 m^3

3)

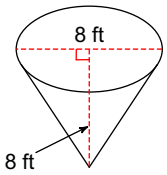

A) 145 ft^3 B) 134 ft^3
C) 157 ft^3 D) 536 ft^3

4)

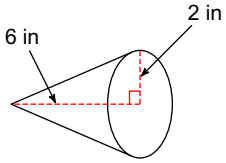

A) 17 in^3 B) 28 in^3
C) 35 in^3 D) 25 in^3

5)

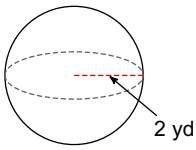

A) 41 yd^3 B) 36 yd^3
C) 34 yd^3 D) 30 yd^3

6)

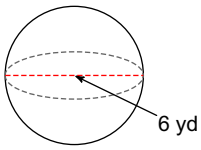

A) 113 yd^3 B) 121 yd^3
C) 905 yd^3 D) 148 yd^3

© 2016 Kuta Software LLC. All rights reserved. Made with Infinite Geometry.